Worksheet 12

Add the missing bar lines in each of the following:

a)



b)



c)



d)



e)



f)



g)



h)



i)